RTD EXAM PREP

Visit rtdlearning.com for more learning support
Visit rtdacademy.com to take a for credit math course with us!

Part 1 – Radical Functions / Square Root of a Function

1. For a function defined by $y = -2\sqrt{x+3}+5$,

(a) State the domain and range, and explain how they relate to the parameters of the equation in the form $a\sqrt{x-h}+k$

(b) Algebraically determine any x, y intercepts
Exact values

2. *Exam-style Question*

NR ☐☐☐☐

A radical function $r(x)$ has a domain of $x \geq -2$, a range $y \geq -3$, and has an x-intercept $x = -1$. For an equation in the form $y = a\sqrt{x-h}+k$, the value of a is _____.

www.math30-1power.com

Answers are on the back page
Full, worked out solutions can be found at www.rtdmath.com

3. *Exam-style Question*

MC (A) (B) (C) (D)

A radical function has an equation . The domain of the function is:

A. $x \geq \frac{6}{b}$ B. $x \geq 6$ C. $x \geq \frac{-6}{b}$ D. $x \geq -6$

4. For each given graph of $y = f(x)$, sketch the graph of $y = \sqrt{f(x)}$, and state its domain, range, and any invariant points.

(a)

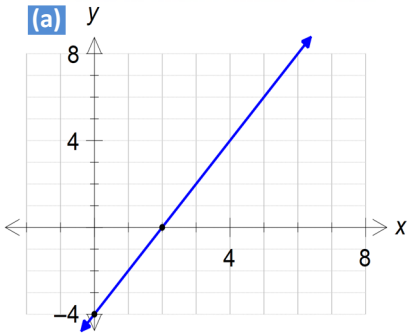

Domain of $y = \sqrt{f(x)}$:

Range of $y = \sqrt{f(x)}$:

Equation of $y = \sqrt{f(x)}$

(b)

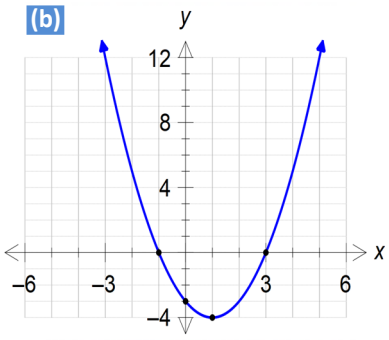

Domain of $y = \sqrt{f(x)}$:

Range of $y = \sqrt{f(x)}$:

Equation of $y = \sqrt{f(x)}$

(c) For both functions above (from parts ***a*** and ***b***), determine the coordinates of any invariant points. *Exact values where applicable.*

5. Give the graph of $y = f(x)$ on the right, sketch the graph of $y = \sqrt{f(x)}$ and state the domain and range. Algebraically determine the coordinates of any invariant points.

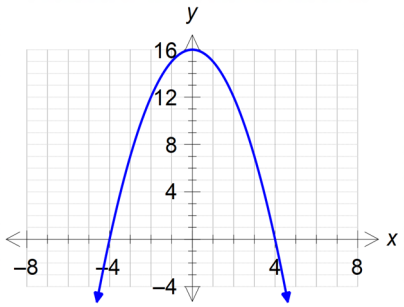

16

Use the following information to answer the following three questions

The graphs of two functions, $y = f(x)$ and $y = g(x)$ are shown. ➔

The graph of $f(x)$ is a line, while the graph of $g(x)$ is a parabola with its vertex on the x-axis.

A function $h(x)$ is defined $h(x) = g(x) + 1$

A function $p(x)$ is defined $p(x) = g(x) + 4$

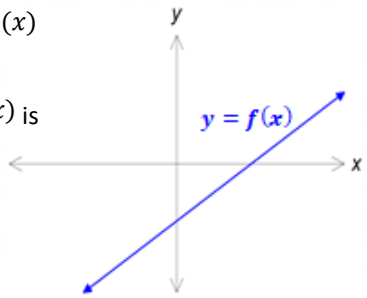

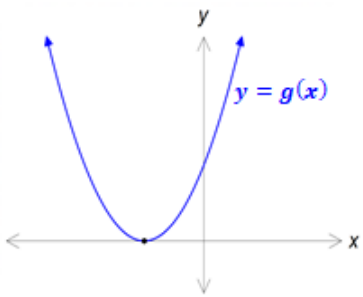

RTD Exam Prep

6. *Exam-style Question*

NR

The most likely domain for $y = \sqrt{f(x)}$ is _____ and for $y = \sqrt{g(x)}$ is _____.
first digit *second digit*

Use the following codes to complete the sentence above

Possible domains **1** $x \in R$ **2** $x \geq -1$ **3** $x \geq 3$ **4** $x \neq -1$ **5** $x \geq 0$ **6** $x \neq 3$

7. *Exam-style Question*

NR

The most likely range for $y = \sqrt{f(x)}$ is _____ and for $y = \sqrt{p(x)}$ is _____.
first digit *second digit*

www.math30-1power.com

Use the following codes to complete the sentence above

Possible ranges **1** $y \in R$ **2** $y \geq 0$ **3** $y \geq 1$ **4** $y \geq 2$ **5** $y \geq 3$ **6** $y \geq 4$

8. *Exam-style Question*

NR

The number of invariant points on $y = \sqrt{f(x)}$ is _____, for $y = \sqrt{g(x)}$ is _____, and for $y = \sqrt{h(x)}$ is _____.
first digit *second digit* *third digit*

Part 2 – Rational Functions

9. Given a function $y = \dfrac{2x - 5}{x + 1}$, determine (without the use of technology):

(a) The equation of any vertical asymptote

(b) The equation of any horizontal asymptote

(c) The value of any x or y intercepts

10. Determine (without the use of technology) any vertical or horizontal asymptote(s) for each given function:

(a) $f(x) = \dfrac{5}{x^2 - 3x - 4}$ **(b)** $f(x) = \dfrac{2x^2}{x^2 - 3x}$ **(c)** $f(x) = \dfrac{3}{x+1} - 2$

11. A function $g(x) = \dfrac{3(x+2)(x-a)}{(x-3)}$, where $a \in N$, has a domain of $\{x \in R \mid x \neq 3\}$ and a graph with no vertical asymptotes. Determine the x-intercept and coordinates of the point of discontinuity.

12. Given a function $y = \dfrac{x+3}{x^2 - x - 12}$, determine (without the use of technology):

(a) The equation of any vertical asymptote(s)

(b) The equation of any horizontal asymptote

(c) The coordinates of any point(s) of discontinuity

13. The rational function shown ➔ has a vertical asymptote at $x = -1$, passes through the origin, and passes through the point $(1, -1)$. Determine a possible equation, in the form

$y = \dfrac{f(x)}{g(x)}$ *where $f(x)$ and $g(x)$ are both linear functions*

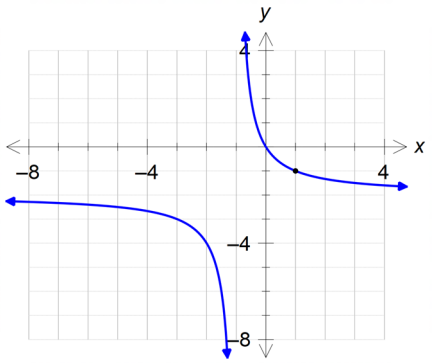

14. The rational function shown ➔ has one vertical asymptote, one point of discontinuity, and passes through the point $(-3, 2)$. Determine a possible equation, in the form

$y = \dfrac{a(x-b)}{x^2 + cx - d}$

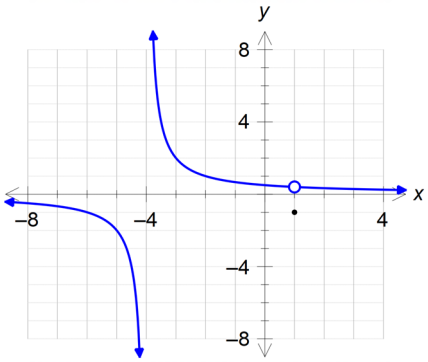

Use the following information to answer the following three questions

A function $f(x)$ is given by $f(x) = \dfrac{a(x-b)(x-3)}{2x^2 - 5x - 3}$, where $a \neq 0, b \neq 3$ and $b \in$ Integers

15. *Exam-style Question* MC (A) (B) (C) (D)

The graph of $y = f(x)$ has a vertical asymptote at:

A. $x = a$ B. $x = -\frac{1}{2}$ C. $x = b$ D. $x = 3$

16. *Exam-style Question* MC (A) (B) (C) (D)

The graph of $y = f(x)$ has an x-intercept at:

A. $x = a$ B. $x = 3$ C. $x = -\frac{1}{2}$ D. $x = b$

17. *Exam-style Question* MC (A) (B) (C) (D)

The graph of $y = f(x)$ has a horizontal asymptote at:

A. $y = a$ B. $y = 0$ C. $y = \dfrac{a}{2}$ D. $y = \dfrac{b}{2}$

18. *Exam-style Question* NR

A rational function given by $y = \dfrac{x^2 - 5x + b}{x - a}$ has a point of discontinuity at $(3, 1)$.

The value of a is _____ and the value of b is _____.
first digit *second digit*

19. *Exam-style Question* NR

A rational function given by the graph shown has an equation of the form $y = \dfrac{a(x-1)(x-b)}{x^2 - 5x + c}$ *where a, b, and c are positive integers.* The graph has a point of discontinuity, an x-intercept, and vertical asymptote as shown.

The value of a is _____, b is _____, is _____.
first digit *second digit* *third digit*

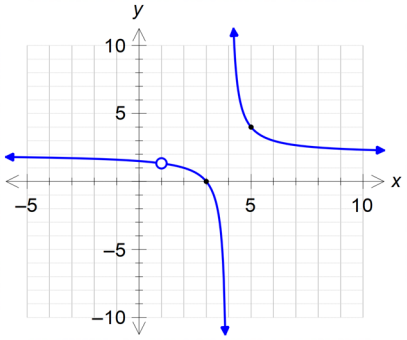

Answers For full, worked-out solutions (as well as other practice materials) visit **www.rtdmath.com**

1. (a) $x \geq -3,\ y \leq 5$ **(b)** $y = -2\sqrt{3} + 5 \quad x = 3.25$ **2.** $a = 3$ **3.** C **4.(a)** $x \geq 2,\ y \geq 0,\ y = \sqrt{2x - 4}$

4.(b) $x \leq -1$ or $x \geq 3 \quad y \geq 0 \quad y = \sqrt{(x+1)(x-3)}$ **4.(c)** *For (a)...* $(2, 0)$ & $(5/2, 1)$ *For (b)...* $(-1, 0), (3, 0), (1 - \sqrt{5},\ 1), (1 + \sqrt{5},\ 1)$

5. Domain: $[-4,\ 4]$ Range: $[0,\ 4]$ INV Pts: $(-4, 0), (4, 0), (-\sqrt{15},\ 1), (\sqrt{15},\ 1)$ **6.** 31 **7.** 24 **8.** 231

9. (a) $x = -1$ **(b)** $y = 2$ **(c)** $x = 5/2,\ y = -5$ **10. (a)** $x = -1$ and $4,\ y = 0$ **(b)** $x = 0$ and $3,\ y = 2$ **(c)** $x = -1, y = -2$

11. $(3, 15)$ **12. (a)** $x = 4$ **(b)** $y = 0$ **(c)** $(-3, -1/7)$ **13.** $y = \dfrac{-2x}{x+1}$ **14.** $y = \dfrac{2(x-1)}{x^2 + 3x - 4}$

15. B **16.** D **17.** C **18.** 36 **19.** 234

This practice exam is provided by RTD Learning - for use by Alberta students and classroom teachers